Quartsextakkord I

1. Bestimmen Sie die Art der Quartsextakkorde in den folgenden Beispielen.



2. Bestimmen Sie die Funktion der folgenden Bässe (wo und welcher 46-Akkord kann mansetzen?) und vervollständigen Sie sie für vier Stimmen.











©Jun-Long Liu 劉俊龍 https://gbonline.liumusic.site